Name: _____ Date: _____

Finding fractions

Find fractions of amounts

You will need:
- 12 counters

Take 12 counters.

Use the boxes below to see if they can be divided into these fractions.

Put a ✓ or ✗ next to the fractions.

Fraction	✓ or ✗
Halves	
Thirds	
Quarters	
Sixths	

Remember fractions are always equal so you must have the same amount in each box.

- Halves $\frac{1}{2}$



- Thirds $\frac{1}{3}$

- Quarters $\frac{1}{4}$



- Sixths $\frac{1}{6}$